Title

O-Level & IGCSE Topical Pakistan Studies

(PAPER-2)

Environment of Pakistan

Published by

Rabbani Publications Center

Rabbani Photo Copier

Arranged & Designed by

Muhammad Majid Hussain

Legal Advisor

Ch. Muhammad Naseer (Kakuana)
Advocate Hight Court
0300-7658213
Chamber # 26, Randhawa Law Building
Near CPO office Distt. Katchery, Faisalabad.

Mian Zahid Iqbal
Advocate Hight Court
0321-7618063
Chamber # 26, Randhawa Law Building
Near CPO office Distt. Katchery, Faisalabad.

For Complaints/Order

Rabbani Publications
36-Z, Commercial Center, Near Mujahid Hospital, Madina Town, Faisalabad.
0332-6682372, 0300-4537372
(rabanipublications@gmail.com)

Rabbani Photo Copier
Corner Jamia Masjid Technical, D-Ground Faisalabad.
0300-6682372
(rabaniphotostate@gmail.com)

Price

PREFACE

IN THE NAME OF ALLAH, MOST GRACIOUS AND MOST MERCIFUL.

Excellence is not an art. It is the habit of practice. In this regard the concepts learnt can only be assessed when questions are answered. The perfect logical approach to this is to take one step at a time.

Chapter wise learning and its application on exam-based questions provides exclusive comprehension. This booklet is the perfect resource for the practice of complete Pakistan Studies O'Level syllabus. This compilation has been refined by experts who have tried to make this book error free.

The book has been edited and checked to remove possible mistakes. However, constructive criticism is welcome. You may call us for your productive feedback and suggestions at this No. (0332-6682372) . This book is recommended by all renowned Pakistan Studeis teachers who contributed to make it effective and fruitful.

This book provides:

- Knowledge with understanding.
- Handling information and solving problems or Experimental skills and investigation.
- Sorted/separated questions or parts of questions, placed in related classified topics.
- Questions in order from the early years to most recent years.
- Answering Key/ Mark Scheme at the end of each topic.
- Actual spacing between consecutive questions and within options as per CAIE format which gives students a genuine feel of attempting questions. In addition to all this; review, feedback and contribution in this booklet by various experienced teachers of the subject belonging to popular school chains makes it a treasured resource for both the teachers and the students.

in case of any suggestion for improvement Team Head can be contacted at

Cell: 0332-6682372 / Email: rabanipublications@gmail.com

COPY RIGHTS RESERVED.

All rights reserved. Apart from any use permitted under PAK copyright law, no part of this publication may be reproduced or transmitted in any form or by any means, electronic or mechanical, including photocopying and recording, or held within any information storage and retrieval system, without permission in writing from the publisher or under licence from the Copyright Licensing Agency Limited. Further details of such licences (for reprographic reproduction) may be obtained from the Copyright Licensing Agency.

Printed in Faisalabad-Pakistan.

Quality Policy

- Customer satisfaction is our priority and achieve this goal we will always, work as a team.
- Produce and supply finest quality goods meeting all the specification including Environmental concern and safety
- Every employee will influence to contribute towards
- Quality improvement to sustain through ideas and innovation.

- گاہک کا اطمینان ہماری اولین ترجیح ہے۔
- اپنے مقصد کے حصول کیلئے ہم ہمیشہ بحیثیت ایک ٹیم کام کرتے ہیں۔
- گاہک کی ضروریات اور ماحولیاتی حالات اور احتیاطی تدابیر کہ مدنظر رکھتے ہوئے معیاری اشیاء فراہم کرتے ہیں۔
- ہر فرد اپنے خیالات اور تخلیقات کے ذریعے بہتر کوالٹی اور اس کو برقرار رکھنے کیلئے موثر کردار ادا کرتا ہے۔

CONTENTS

1	**Land of Pakistan**	01
	(Marking Scheme)	28
2	**Climate**	46
	(Marking Scheme)	73
3	**Water Drainage and Irrigation**	99
	(Marking Scheme)	117
4	**Forest**	135
	(Marking Scheme)	148
5	**Minerals**	158
	(Marking Scheme)	174
6	**Fishing**	187
	(Marking Scheme)	196
7	**Power Minerals**	204
	(Marking Scheme)	211
8	**Agriculture**	216
	(Marking Scheme)	255
9	**Electricity**	287
	(Marking Scheme)	308
10	**Industries**	327
	(Marking Scheme)	361
11	**Tourism**	394
	(Marking Scheme)	406
12	**Trade**	414
	(Marking Scheme)	425
13	**Transport**	436
	(Marking Scheme)	460
14	**Population**	481
	(Marking Scheme)	528

Q1(a,b)/02/M/J/19

1 **(a)** Study Fig. 1.1, an outline map of Pakistan.

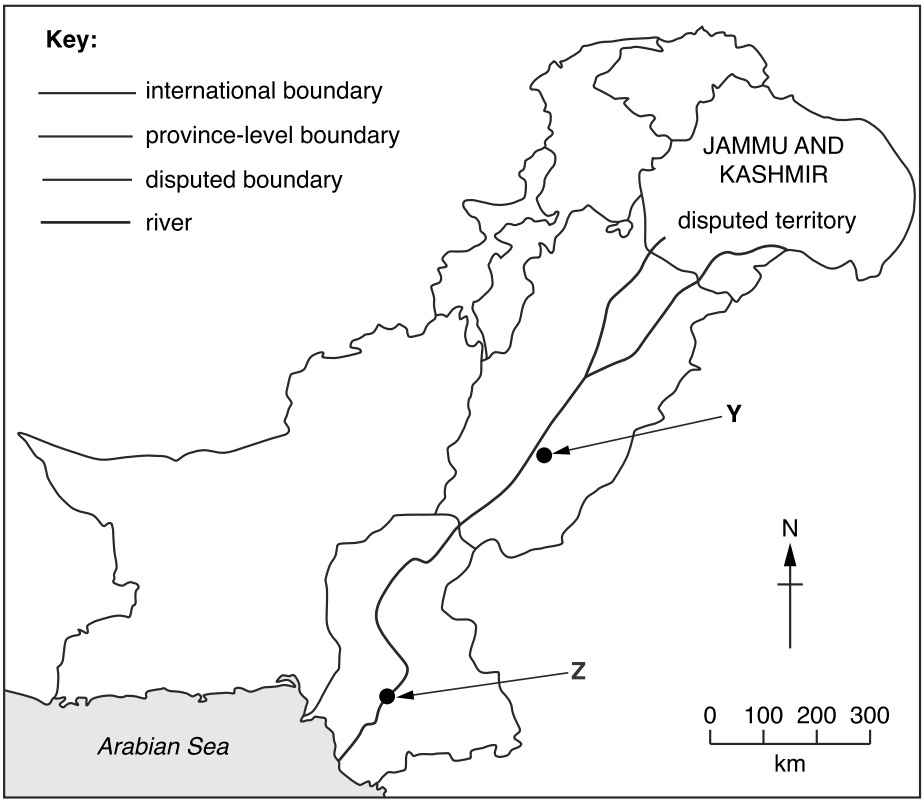

Fig. 1.1

(i) **Label on Fig. 1.1** the province-level areas in the correct locations using the letters from the list below.

letter	province-level area
A	Balochistan
B	FATA
C	Northern Areas/Gilgit-Baltistan
D	Kyber Pakhtunkhwa (KPK)
E	Punjab
F	Sindh

[3]

(ii) Name the cities **Y** and **Z**.

Y .....

Z .....

[2]

RABBANI BROTHERS & SON's

(b) (i) Describe the characteristics of a floodplain.

.....

.....

.....

.....

.....

..... [3]

(ii) State **two** ways that land on a floodplain is used.

1 .....

2 ..... [2]

RABBANI BROTHERS & SON's

Q1(a,b)/02/O/N/19

2 **(a)** Study Fig. 1.1, an outline map of Pakistan.

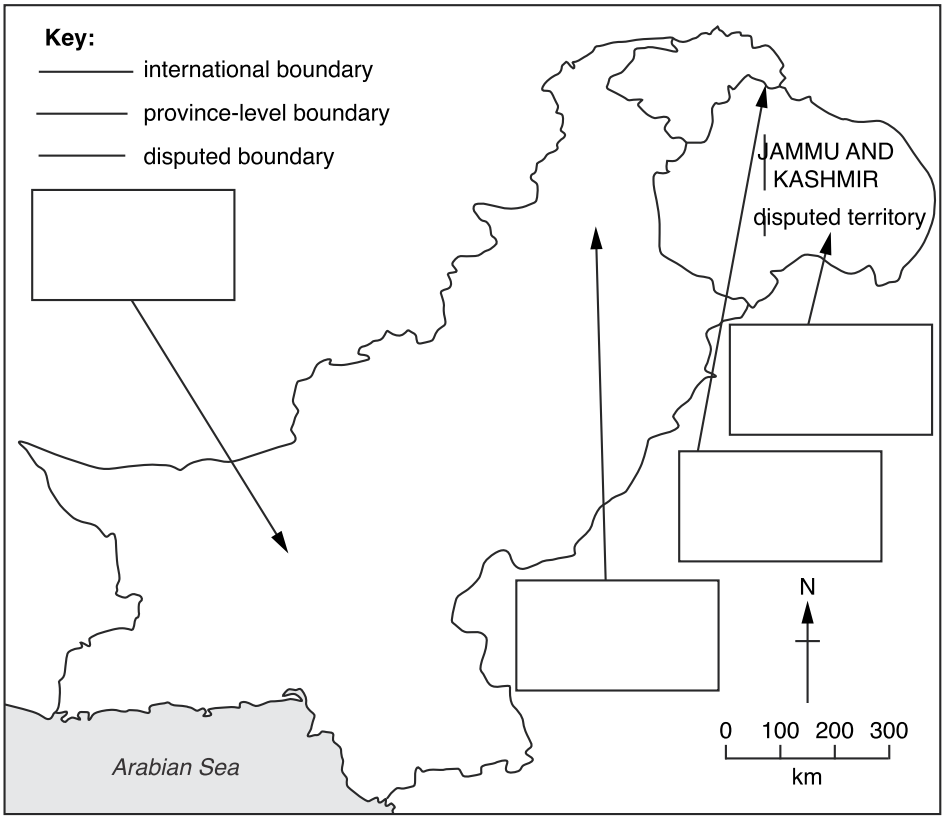

Fig. 1.1

(i) **On the map** name the following landforms **in the boxes** provided: Balochistan Plateau; Himalayan Ranges; Karakoram Range; Salt Range. [4]

.....

.....

.....

.....

.....

.....

.....

.....

.....

RABBANI BROTHERS & SON's

(ii) Study Fig. 1.2 (Insert). Identify the mountain feature labelled **A** in the photograph.



Fig. 1.2

A .....

[1]

(b) (i) Define the term 'topography'.

.....

..... [1]

(ii) Describe the natural topography of the northern regions.

.....

.....

.....

.....

.....

..... [3]

RBC
RABBANI BROTHERS & SON's

Q1(a)/02/M/J/20

3 (a) (i) Study Fig. 1.1, a map of Pakistan.

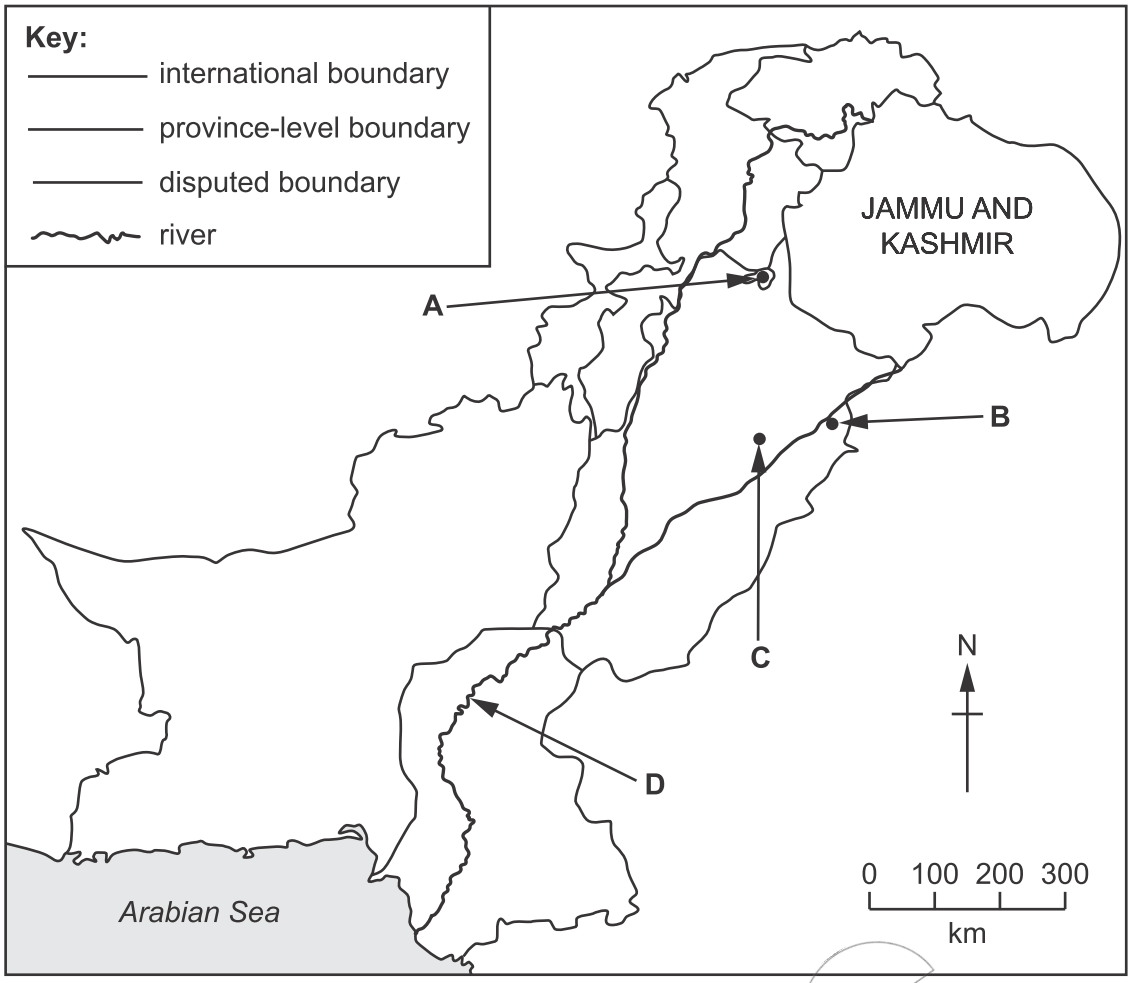

Fig. 1.1

Name the **three** cities labelled **A**, **B** and **C** on Fig. 1.1.

A .....

B .....

C .....

[3]

(ii) Name the river labelled **D** on Fig. 1.1.

D ..... [1]

RABBANI BROTHERS & SON's

Q3(a,i,ii)/02/M/J/20

4 (a) (i) Study Fig. 2.1, a map of Pakistan.

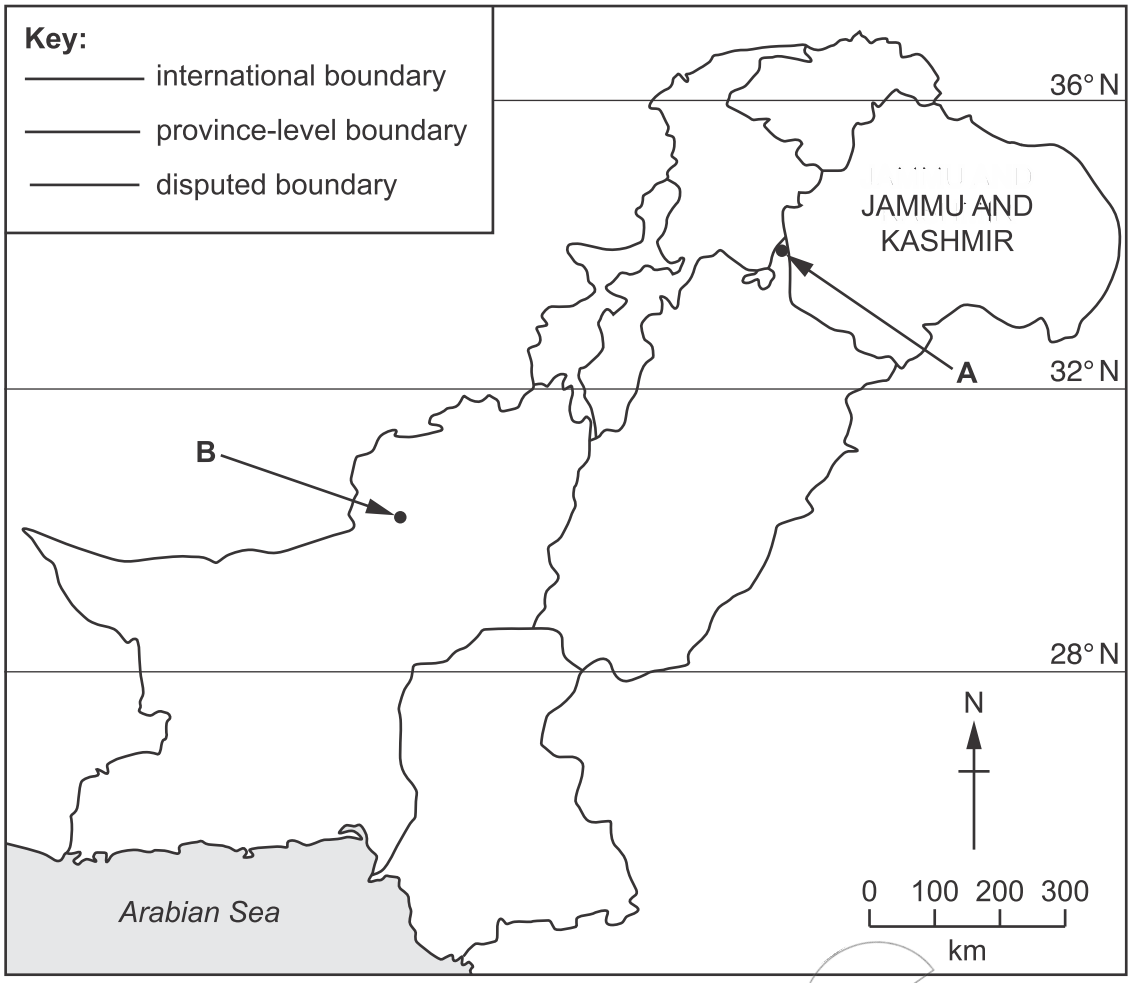

Fig. 2.1

Name the **two** cities labelled **A** and **B** on Fig. 2.1.

A .....

B .....

[2]

RABBANI BROTHERS & SON's

(ii) Study Fig. 2.2, climate graphs showing rainfall and temperature for cities **A** and **B**.

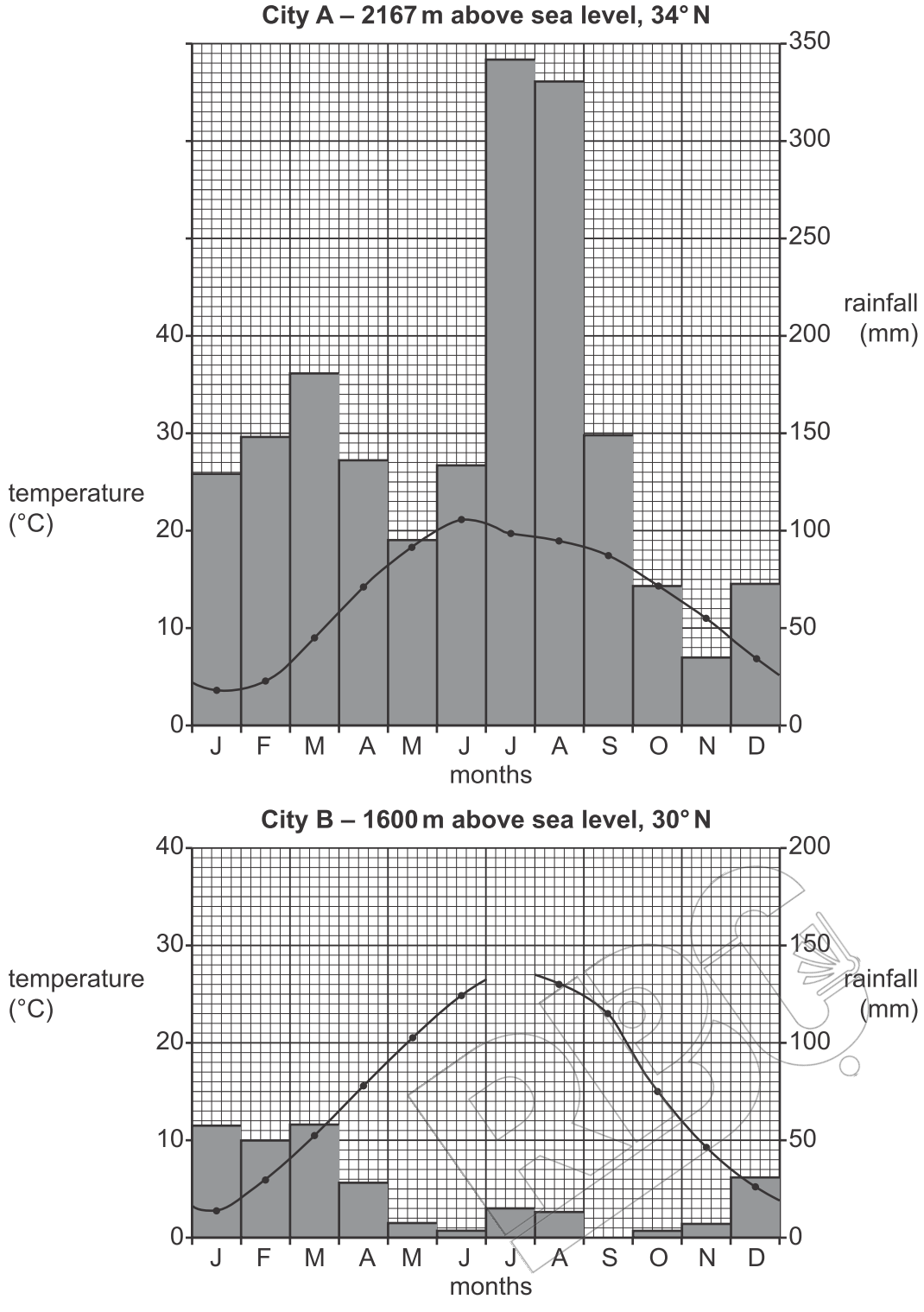

Fig. 2.2

Complete the climate graph for city **B** using the information below.

month	temperature (°C)
July	28

[2]

RABBANI BROTHERS & SON's

Q1/02/O/N/21

5 Study Fig. 1.1, a map showing the natural topography of southern and western Pakistan.

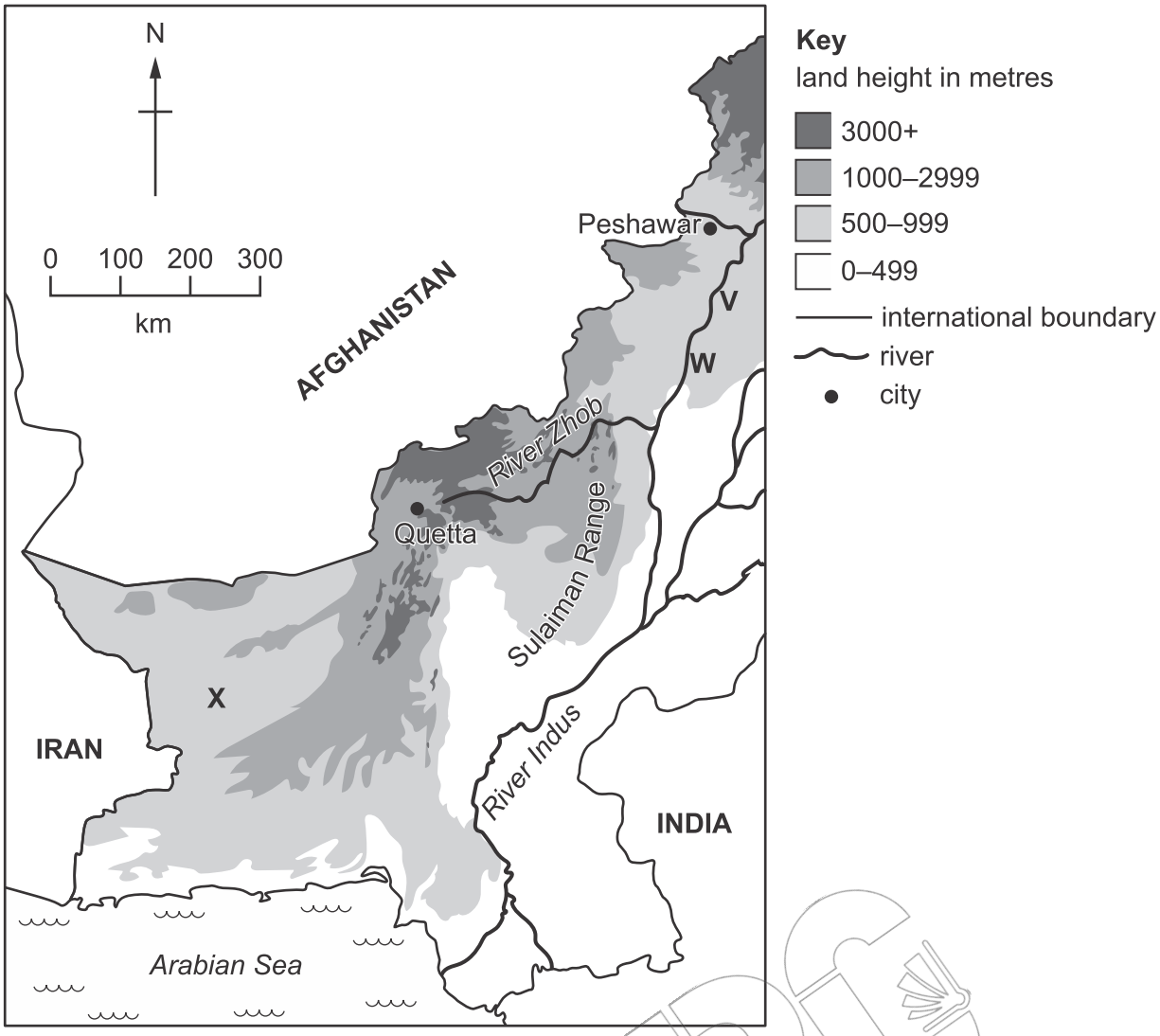

Fig. 1.1

(a) For the landforms labelled **V**, **W** and **X** on Fig. 1.1, circle the correct answer below:

(i) V

Balochistan Plateau Potwar Plateau Salt Range [1]

(ii) W

Balochistan Plateau Potwar Plateau Salt Range [1]

(iii) X

Balochistan Plateau Potwar Plateau Salt Range [1]

RABBANI BROTHERS & SON's

(iv) Using Fig. 1.1 **only**, describe the location of the Sulaiman Range.

.....

.....

.....

.....

.....

..... [3]

(b) (i) Study Fig. 1.2 (Insert), a photograph of the Salt Range. Using Fig. 1.2 **only**, describe **two** features of the Salt Range.

.....

.....

.....

..... [2]

Fig. 1.2

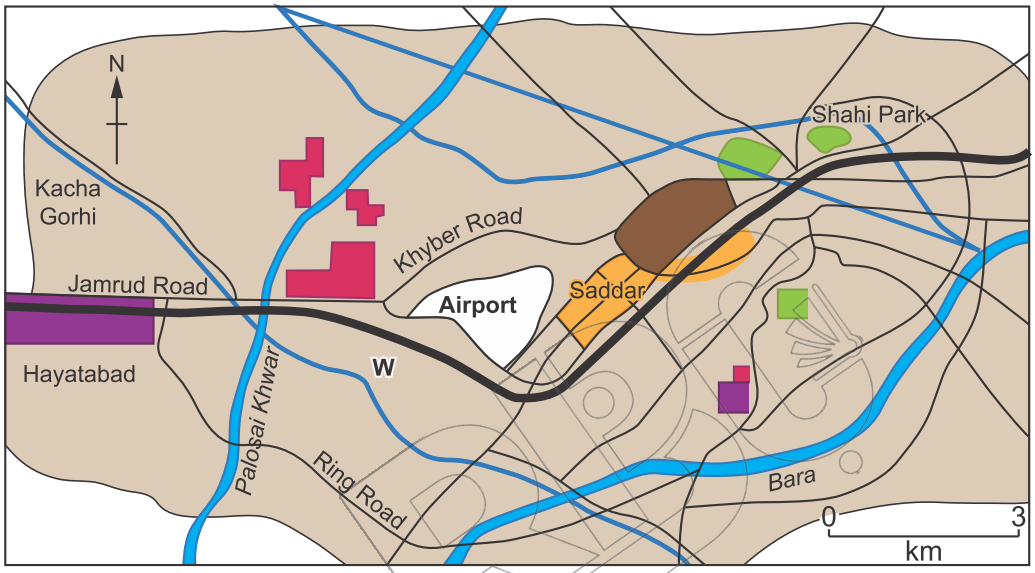

Key

- main commercial area (city centre)
- administrative
- residential
- universities
- industrial
- parks and open space
- airport
- city boundary
- road
- railway
- canal
- river

RABBANI BROTHERS & SON's

(ii) Name **two** minerals that can be obtained from the Salt Range and suggest **one** use for each.

mineral 1 .....

use .....

mineral 2 .....

use .....

[4]

(c) (i) Explain **two** ways in which the natural topography of the Salt Range makes mineral exploitation difficult. You should develop your answer.

1 .....

.....

.....

.....

2 .....

.....

.....

.....

[4]

RABBANI BROTHERS & SON's

Q1(a,i)/02/M/J/22

6 (a) (i) Study Fig. 1.1, a map of southern and western Pakistan.

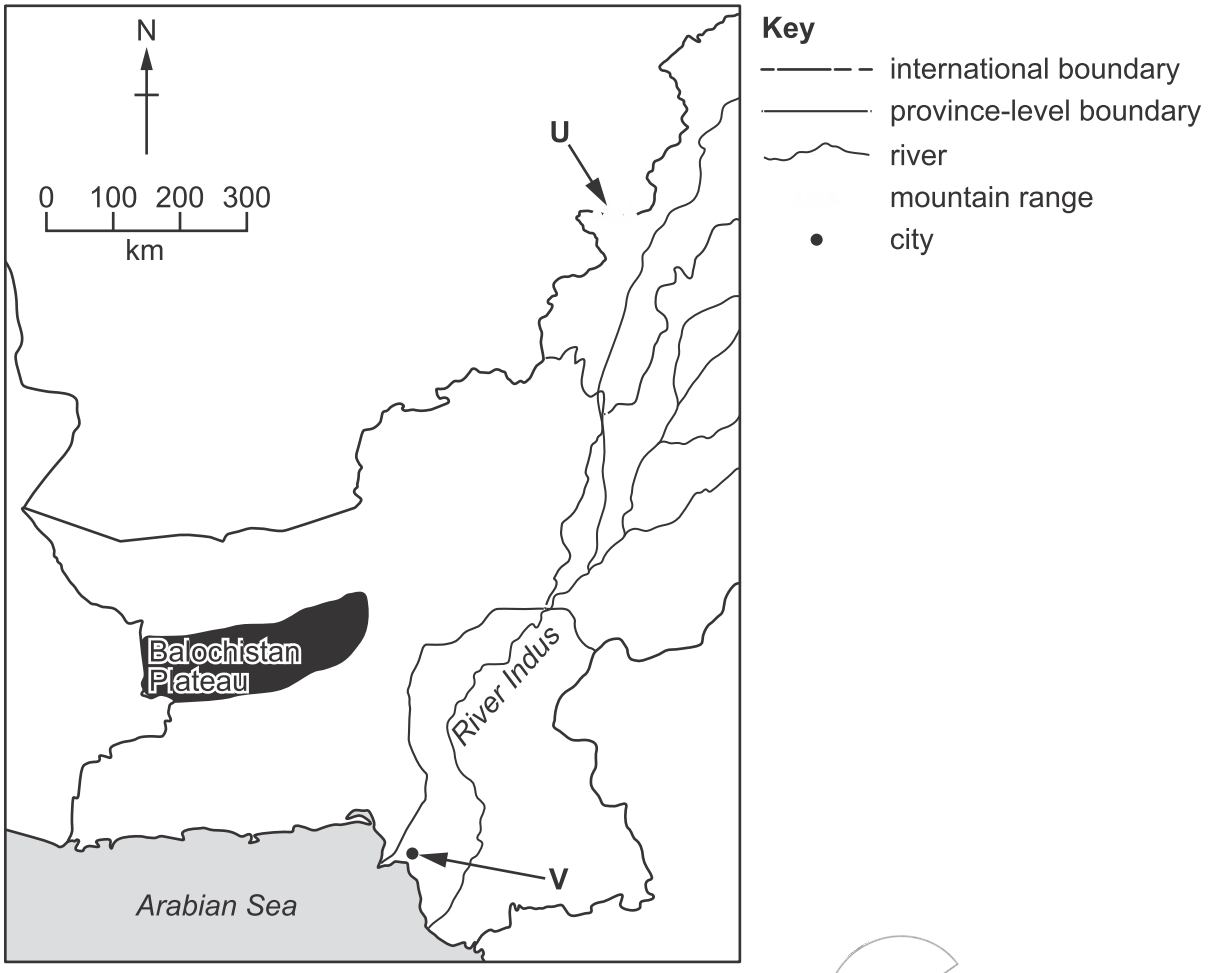

Fig. 1.1

Name landform **U** and city **V** shown in Fig. 1.1.

U .....

V .....

[2]

RABBANI BROTHERS & SON's